Finding Angles within Shapes Name:

Count the number of Acute, Obtuse and Right and Reflex angles in each shape.

Ex)

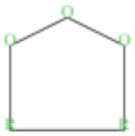

1)

2)

3)

4)

5)

6)

7)

8)

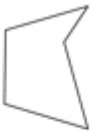

9)

10)

11)

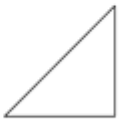

Answers

	A	O	R	X
Ex.	0	3	2	0
1.				
2.				
3.				
4.				
5.				
6.				
7.				
8.				
9.				
10.				
11.				

1-10	91	82	73	64	55	45	36	27	18	9
11	0									